N.º III

PERFIL Y ELEVACION
QUE PASA POR LA LINEA AB.



(c) Real Academia de la Historia

N.º III

PERFIL Y ELEVACION
QUE PASA POR LA LINEA AB.





A

Perfil y elevacion que pasa por la linea E.F.



E

Perfil del muro que demuestra la posicion y altura de los caños sobre el nivel del mar.

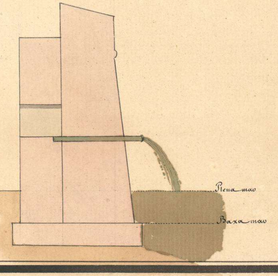

F

Perfil y elevacion que pasa por la linea C.D



C D

Perfil de la Fuente.

(c) Real Academia de la Historia

PERFIL Y ELEVACION
QUE PASA POR LA LINEA AB.

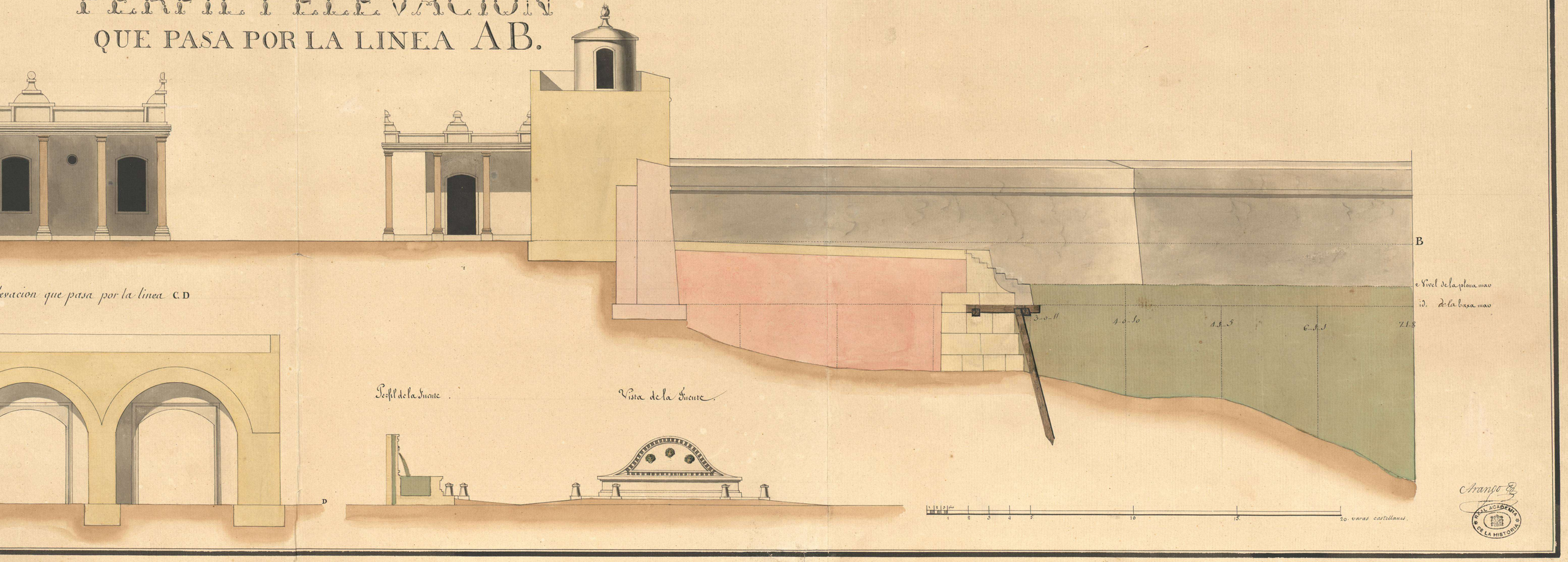

(c) Real Academia de la Historia